Name _____ Hour _____

## 4-6 Isosceles and Equilateral Triangles Worksheet

**Use the figure to find the measure of each angle.**

1.

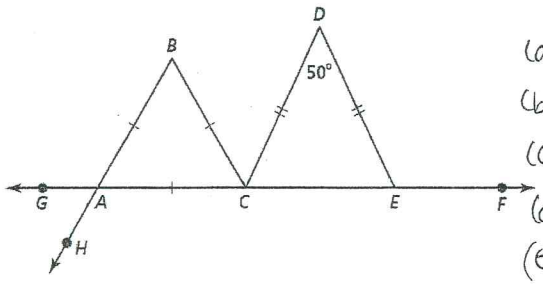


(a) $m\angle BCA$

(b) $m\angle DCE$

(c) $m\angle DEF$

(d) $m\angle BCD$

(e) $m\angle BAG$

(f) $m\angle GAH$

**2.** Is every equilateral triangle isosceles? Is every isosceles triangle equilateral? Explain your reasoning.

**Find the unknown measures.**

3.

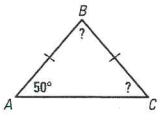


4.

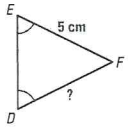


5.

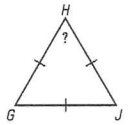


**Solve for x and y.**

6.

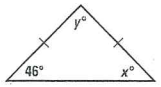


7.

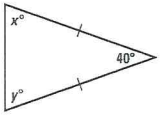


8.

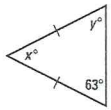


9.

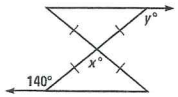


10.

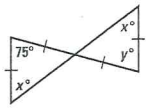


11.

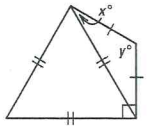


12.

Use the diagram to explain why $\triangle PQR$ is isosceles.

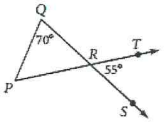


13.

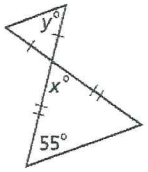


14.

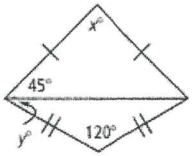


**Find the value of the missing variables.**

15.

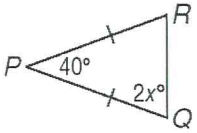


16.

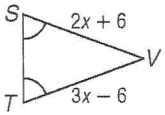


17.

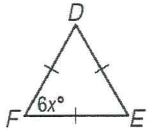


18.

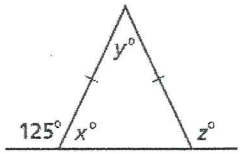


19.

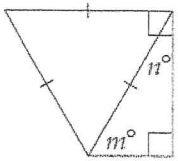


20.

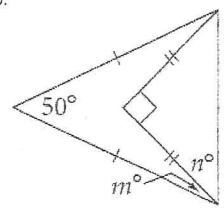


21.

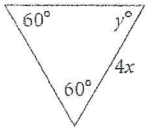


Perimeter is 54.

22.

The perimeter of $\triangle QRS$ is 344 cm. $m\angle Q$ = _____, $QR$ = _____

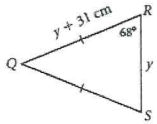


23.

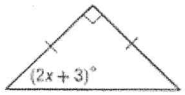

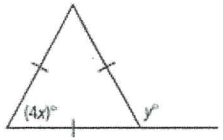
24.